Zu Punktebildern Tauschaufgaben finden

1 Schreibe unter jedes Punktebild zwei Malaufgaben.

a) 

8 · 4

4 · 8

b) 

·

·

c) 

·

·

d) 

·

·

e) 

·

·

f) 

·

·

g) 

·

·

h) 

·

·

2 Zeichne zu jeder Malaufgabe das Punktebild.
Schreibe dann die Tauschaufgabe darunter.

a) 

6 · 3

·

b) 

5 · 2

·

c) 

6 · 3

·

d) 

4 · 5

·

e) 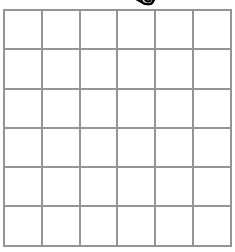

2 · 4

·

f) 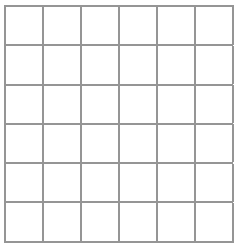

5 · 3

·

g) 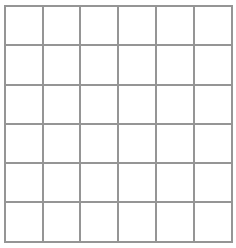

3 · 4

·

h) 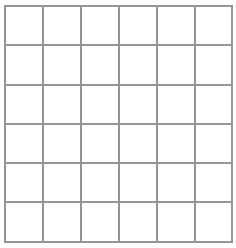

2 · 5

·

© 2014 Cornelsen Schulverlage GmbH, Berlin.
Alle Rechte vorbehalten.